Hour 4: Music Bonus

Identify the well-known musical works of which the following are the opening rhythms

Classical

1.

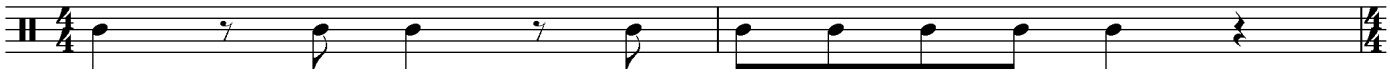

2.



3.



4.



5.



6.



7.



8.



9.



10.



11.


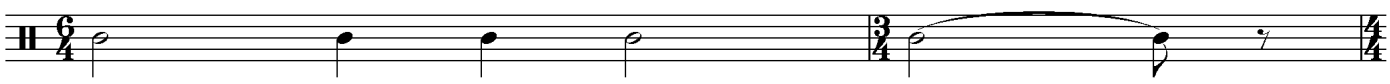
12.